Name: _____ Date: _____



Which Has More?



Circle the group with more. If equal, circle both.

1.





2.

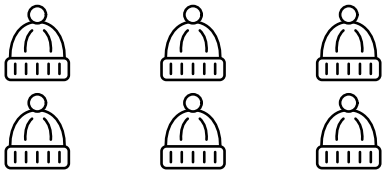

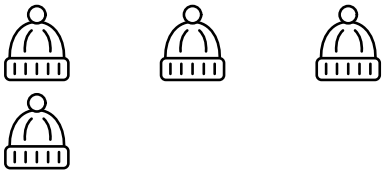

3.





4.





5.

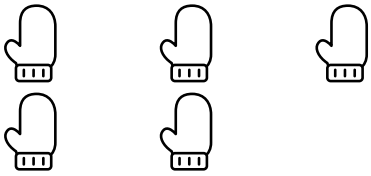

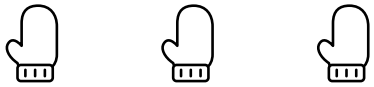

6.



